Name _____ Date _____

1. Fill in the blanks to make true statements.

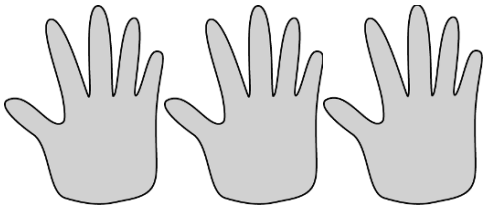

a. 3 groups of five = _____

3 fives = _____

3 × 5 = _____

b. 3 + 3 + 3 + 3 + 3 = _____

5 groups of three = _____

5 × 3 = _____



c. 6 + 6 + 6 + 6 = _____

_____ groups of six = _____

4 × _____ = _____

d. 4 +____ + ____ + ____ + ____ + ____ = _____

6 groups of _____ = _____

6 × _____ = _____

© 2015 Great Minds. eureka-math.org
G3-M1-TE-1.3.0-06.2015

This work is licensed under a Creative Commons Attribution-NonCommercial-ShareAlike 3.0 Unported License.

2. The picture below shows 2 groups of apples. Does the picture show 2 × 3? Explain why or why not.

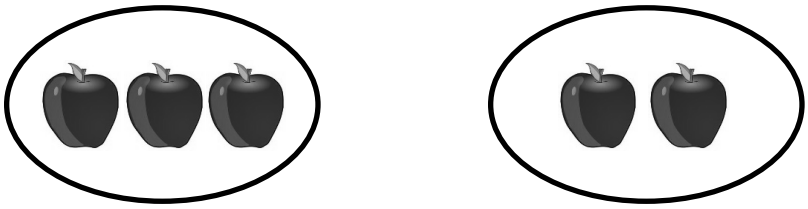

3. Draw a picture to show 2 × 3 = 6.

4. Caroline, Brian, and Marta share a box of chocolates. They each get the same amount. Circle the chocolates below to show 3 groups of 4. Then, write a repeated addition sentence and a multiplication sentence to represent the picture.



© 2015 Great Minds. eureka-math.org
G3-M1-TE-1.3.0-06.2015
This work is licensed under a Creative Commons Attribution-NonCommercial-ShareAlike 3.0 Unported License.